1 ACTIVITY: Drawing Views of a Solid

Work with a partner. Draw the front, side, and top views of each stack of cubes. Then find the number of cubes in the stack.

a.



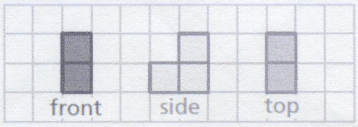

Number of cubes: ☐

b.

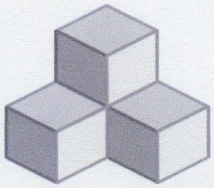

Number of cubes: ☐

c.

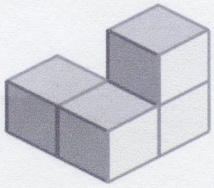

Number of cubes: ☐

d.

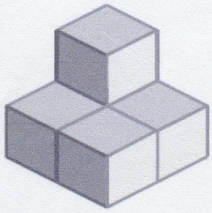

Number of cubes: ☐

e.

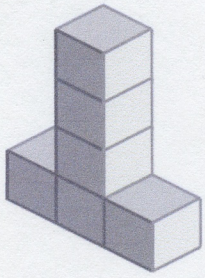

Number of cubes: ☐

f.



Number of cubes: ☐

g.

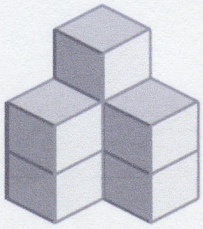

Number of cubes: ☐